# INFO: Winkelarten

Mathematik Messen M 6

Folgende Winkelarten musst du kennen:

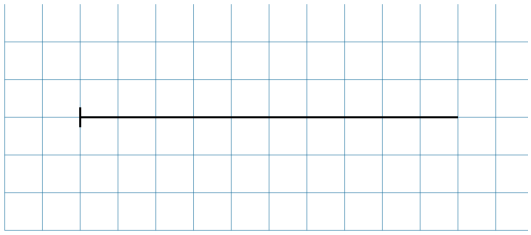

$\alpha = 0^\circ$

Nullwinkel

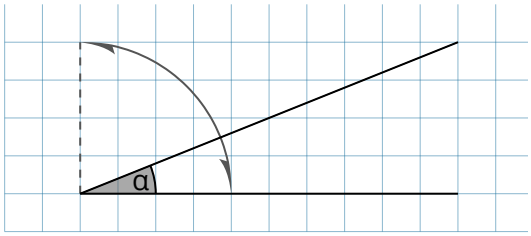


$0^\circ < \alpha < 90^\circ$

Spitzer Winkel

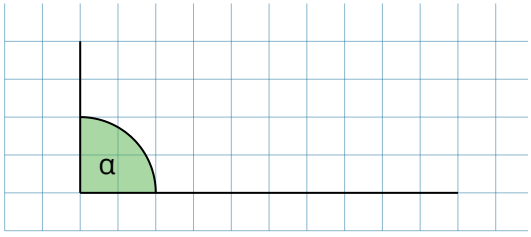


$\alpha = 90^\circ$

Rechter Winkel

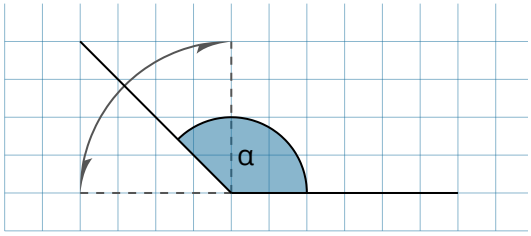


$90^\circ < \alpha < 180^\circ$

Stumpfer Winkel

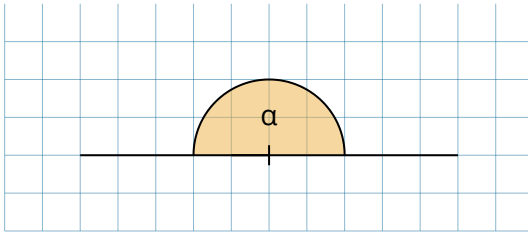


$\alpha = 180^\circ$

Gestreckte Winkel

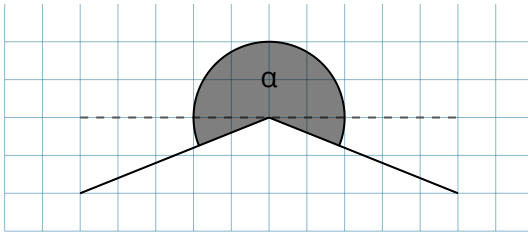


$180^\circ < \alpha < 360^\circ$

Überstumpfer Winkel

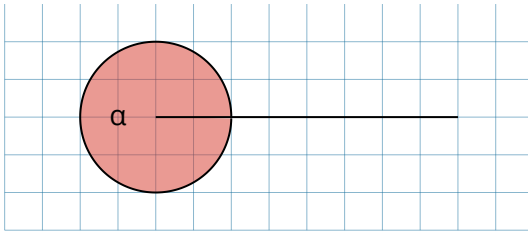


$\alpha = 360^\circ$

Vollwinkel